Learning Leap

Grade 2 • Time & Clocks
learningleap.education

Telling Time & Clocks
Read clocks, draw hands, and solve time questions.

Name: _____ Date: _____

Part A — Write the Time



_____

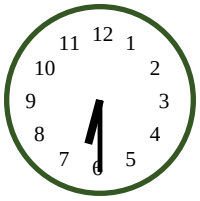

_____



_____



_____

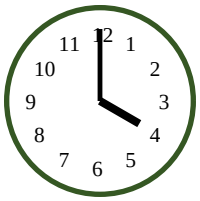

_____

_____

Part B — Draw the Hands

2:00



5:30



11:00



Part C — Time Questions

1. What time comes 1 hour after 3:00? _____

2. What time comes 30 minutes after 5:00? _____

3. What time comes before 8:00? _____

4. Circle the clock showing half past 6.

5. Which clock shows exactly 9 o’clock?

© Learning Leap • learningleap.education

Answer Key — Telling Time & Clocks

Part A
1. 3:00
2. 6:30
3. 9:00
4. 1:30
5. 4:00
6. 7:30

Part B
Students should draw the correct clock hands.

Part C
1. 4:00
2. 5:30
3. 7:00